Prof. Micu Elena

Micu Elena

Nume și prenume elev: _____ Clasa: _____ Data: _____

Fișa nr. 1. Geometrie plană

Clasa a V-a

Notarea unghiurilor

Pentru fiecare item, completați în tabelul de la sfârșitul fișei cerculetul corespunzător variantei care **NU** poate fi o notație a unghiului. Acolo unde în vârf au mai multe unghiuri, întrebarea se referă la unghiul indicat de săgeată.

1.

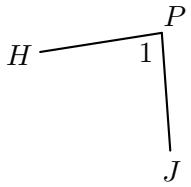

A. $\sphericalangle P$
B. $\sphericalangle HPJ$
C. $\sphericalangle HJP$
D. $\sphericalangle 1$

2.

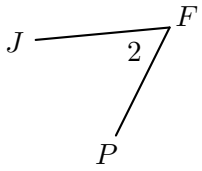

A. $\sphericalangle 2$
B. $\sphericalangle JPF$
C. $\sphericalangle JFP$
D. $\sphericalangle PFJ$

3.

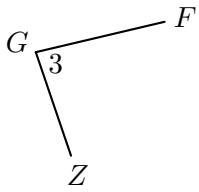

A. $\sphericalangle ZFG$
B. $\sphericalangle 3$
C. $\sphericalangle FGZ$
D. $\sphericalangle ZGF$

4.

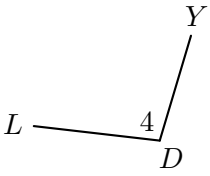

A. $\sphericalangle D$
B. $\sphericalangle LDY$
C. $\sphericalangle YDL$
D. $\sphericalangle YLD$

5.

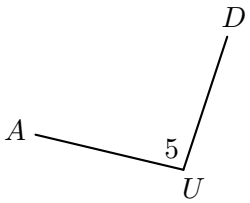

A. $\sphericalangle U$
B. $\sphericalangle ADU$
C. $\sphericalangle DUA$
D. $\sphericalangle 5$

6.

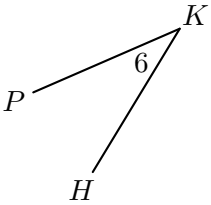

A. $\sphericalangle HPK$
B. $\sphericalangle 6$
C. $\sphericalangle K$
D. $\sphericalangle HKP$

7.

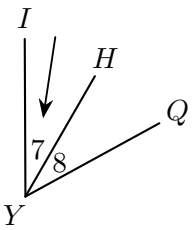

A. $\sphericalangle 7$
B. $\sphericalangle Y$
C. $\sphericalangle IYH$
D. $\sphericalangle HYI$

8.

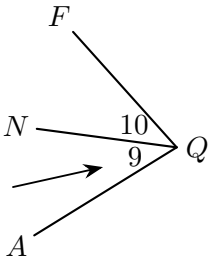

A. $\sphericalangle 9$
B. $\sphericalangle NQA$
C. $\sphericalangle AQN$
D. $\sphericalangle Q$

9.

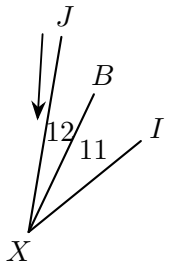

A. $\sphericalangle X$
B. $\sphericalangle JXB$
C. $\sphericalangle BXJ$
D. $\sphericalangle 12$

10.

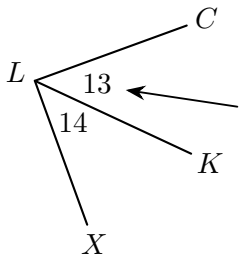

A. $\sphericalangle KLC$
B. $\sphericalangle 13$
C. $\sphericalangle CLK$
D. $\sphericalangle L$

Completați cerculețul corespunzător răspunsului corect pentru fiecare item de mai sus.

1.	**2.**	**3.**	**4.**	**5.**	**6.**	**7.**	**8.**	**9.**	**10.**
◯ A	◯ A	◯ A	◯ A	◯ A	◯ A	◯ A	◯ A	◯ A	◯ A
◯ B	◯ B	◯ B	◯ B	◯ B	◯ B	◯ B	◯ B	◯ B	◯ B
◯ C	◯ C	◯ C	◯ C	◯ C	◯ C	◯ C	◯ C	◯ C	◯ C
◯ D	◯ D	◯ D	◯ D	◯ D	◯ D	◯ D	◯ D	◯ D	◯ D