Prof. Micu Elena
Micu Elena

Nume și prenume elev: _____ Clasa: _____ Data: _____

Fișa nr. 11. Geometrie plană

Clasa a VI-a

Unghiuri complementare și suplementare

Pentru fiecare figură, completați cerculetul: **A** dacă unghiurile sunt complementare, dar nu sunt adiacente; **B** dacă sunt complementare și adiacente; **C** dacă sunt suplementare, dar nu sunt adiacente; **D** dacă sunt adiacente suplementare.

1.

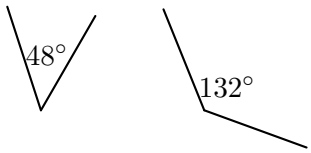

2.

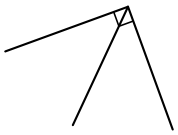

3.

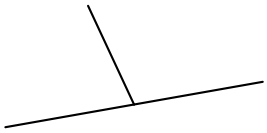

4.

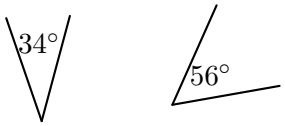

5.

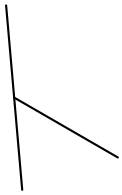

6.

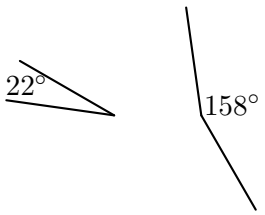

7.

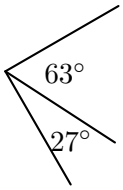

8.

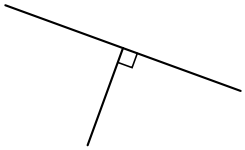

9.

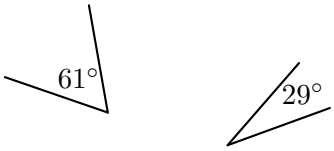

10.

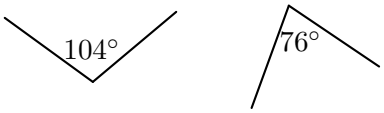

11. Definiți:

Unghiuri complementare: _____

_____

Unghiuri suplementare: _____

_____

Unghiuri adiacente suplementare: _____

_____

1.	**2.**	**3.**	**4.**	**5.**	**6.**	**7.**	**8.**	**9.**	**10.**
◯ A	◯ A	◯ A	◯ A	◯ A	◯ A	◯ A	◯ A	◯ A	◯ A
◯ B	◯ B	◯ B	◯ B	◯ B	◯ B	◯ B	◯ B	◯ B	◯ B
◯ C	◯ C	◯ C	◯ C	◯ C	◯ C	◯ C	◯ C	◯ C	◯ C
◯ D	◯ D	◯ D	◯ D	◯ D	◯ D	◯ D	◯ D	◯ D	◯ D