Prof. Micu Elena
Micu Elena

Nume și prenume elev: _____ Clasa: _____ Data: _____

Fișa nr. 12. Geometrie plană

Clasa a VI-a

Unghiuri complementare și suplementare

Aflați măsura unghiului necunoscut din fiecare figură. Scrieți mai întâi relația dintre măsuri, apoi rezolvați.

1.

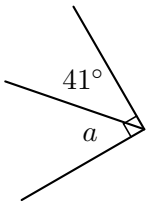

2.

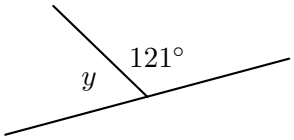

3.

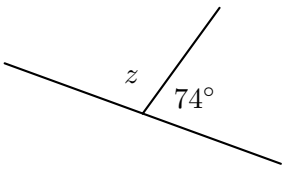

4.

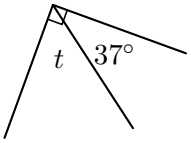

5.

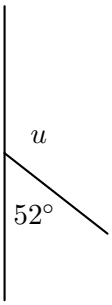

6.

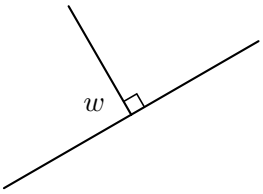

7.

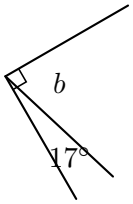

8.

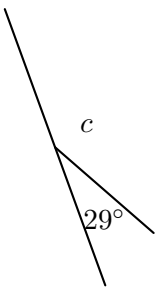

Completați cerculețele corespunzătoare tuturor răspunsurilor corecte de mai sus. Nu completați răspunsurile greșite.

◯63° ◯59° ◯180° ◯139° ◯53° ◯0° ◯49° ◯73° ◯106° ◯90° ◯117° ◯41° ◯31° ◯128° ◯151°