Prof. Micu Elena
Micu Elena

Nume și prenume elev: _____ Clasa: _____ Data: _____

Fișa nr. 2. Geometrie plană

Clasa a V-a

Notarea unghiurilor

Scrieți o altă notație pentru unghiul indicat la fiecare item, folosind notația cu trei litere (vârful se scrie la mijloc).

1. $\sphericalangle 1$

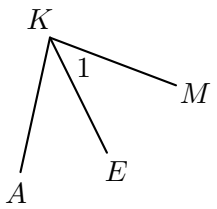

Altă notație: _____

2. $\sphericalangle 2$

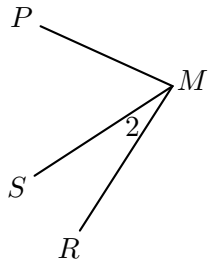

Altă notație: _____

3. $\sphericalangle 3$

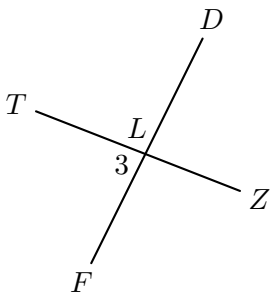

Altă notație: _____

4. $\sphericalangle 4$

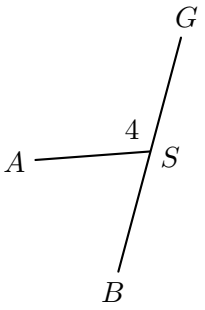

Altă notație: _____

5. $\sphericalangle 5$

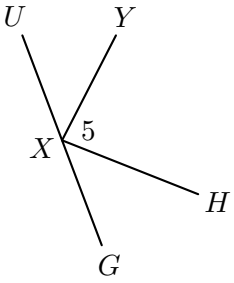

Altă notație: _____

6. $\sphericalangle 6$

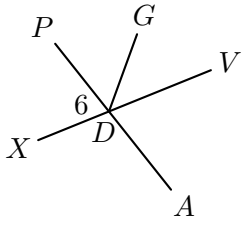

Altă notație: _____

7. $\sphericalangle 7$

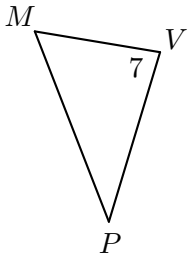

Altă notație: _____

8. $\sphericalangle 8$

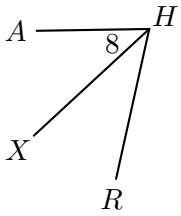

Altă notație: _____

9. $\sphericalangle 9$

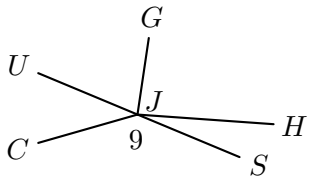

Altă notație: _____

10. $\sphericalangle 10$

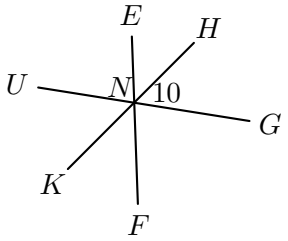

Altă notație: _____