Prof. Micu Elena
Micu Elena

Nume și prenume elev: _____ Clasa: _____ Data: _____

Fișa nr. 5. Geometrie plană

Clasa a V-a

Tipuri de unghiuri

Pentru fiecare dintre unghiurile $\sphericalangle AOB$ de mai jos (cu vârful în punctul O și laturile $[OA$ și $[OB)$, completați cerculeț corespunzător în tabelul de la sfârșitul fișei, după cum unghiul $\sphericalangle AOB$ este: **A** – ascuțit, **B** – obtuz, **C** – drept, **D** – alungit sau **E** – nul.

1.

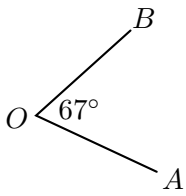

2.

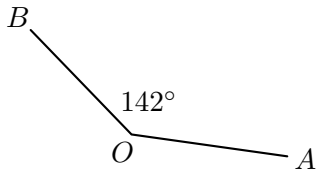

3.

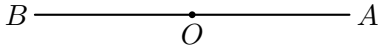

4.

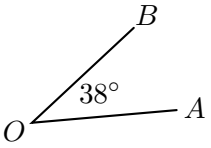

5.

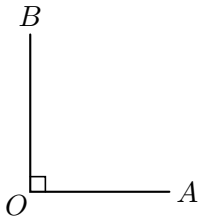

6.

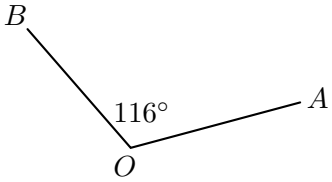

7.

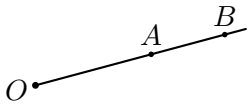

8.

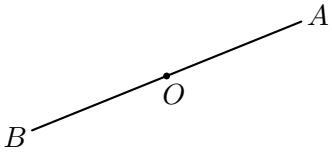

9.

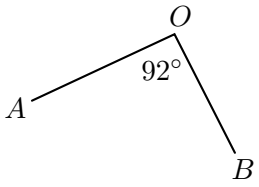

10.

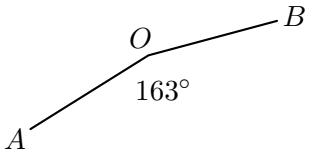

Completați cerculeț corespunzător răspunsului corect pentru fiecare item de mai sus.

1.	**2.**	**3.**	**4.**	**5.**	**6.**	**7.**	**8.**	**9.**	**10.**
◯ A	◯ A	◯ A	◯ A	◯ A	◯ A	◯ A	◯ A	◯ A	◯ A
◯ B	◯ B	◯ B	◯ B	◯ B	◯ B	◯ B	◯ B	◯ B	◯ B
◯ C	◯ C	◯ C	◯ C	◯ C	◯ C	◯ C	◯ C	◯ C	◯ C
◯ D	◯ D	◯ D	◯ D	◯ D	◯ D	◯ D	◯ D	◯ D	◯ D
◯ E	◯ E	◯ E	◯ E	◯ E	◯ E	◯ E	◯ E	◯ E	◯ E