Prof. Micu Elena
Micu Elena

Nume și prenume elev: _____ Clasa: _____ Data: _____

Fișa nr. 7. Geometrie plană

Clasa a VI-a

Unghiuri adiacente

Pentru fiecare figură, stabiliți dacă unghiurile notate cu 1 și 2 sunt adiacente. Dacă sunt adiacente, completați cerculetul **A**; dacă nu sunt adiacente, completați cerculetul **F**.

1.

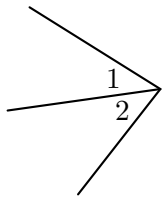

2.

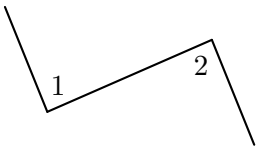

3.

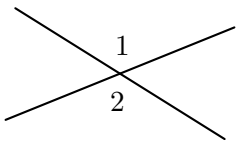

4.

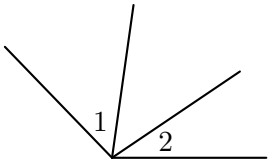

5.



6.

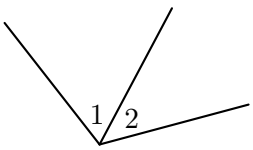

7.

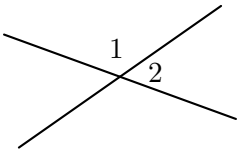

8.

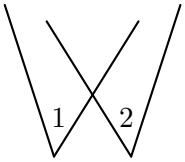

9.

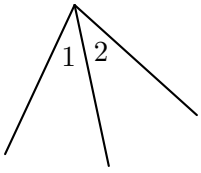

10.

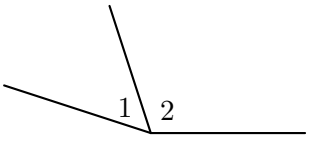

1.	**2.**	**3.**	**4.**	**5.**	**6.**	**7.**	**8.**	**9.**	**10.**
◯A	◯A	◯A	◯A	◯A	◯A	◯A	◯A	◯A	◯A
◯F	◯F	◯F	◯F	◯F	◯F	◯F	◯F	◯F	◯F